Billedsubtraktion

Navn: _____ Dato: _____

Nogle billeder er streget over. Skriv hvor mange der er tilbage.

1



10 − 6 = ☐

2



7 − 2 = ☐

3



10 − 5 = ☐

4

4 − 2 = ☐