Felt for felt

Navn: _____ Dato: _____

Hver ting står på felter. Tæl dem, og skriv længden.

1



2


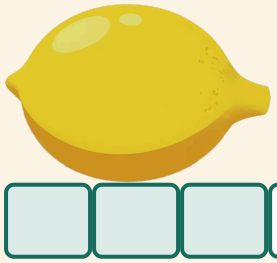
3