Doppio e metà

Nome: _____ Data: _____

Trova il doppio dei gruppi con la scritta «doppio» e la metà dei gruppi con la scritta «metà». Scrivi i numeri nei riquadri.

1

il doppio



4 + 4 = ☐

2

la metà



8 = ☐ + ☐

3

il doppio



2 + 2 = ☐

4

la metà



10 = ☐ + ☐

5

il doppio



3 + 3 = ☐

6

la metà



6 = ☐ + ☐