Brøker på linja

Navn: _____ Dato: _____

Prikken markerer en brøk. Sett ring rundt hvilken.

1

0 → 1 in 6 steps

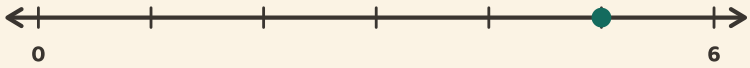

$\frac{5}{6}$ $\frac{4}{8}$ $\frac{4}{6}$

2

0 → 1 in 4 steps

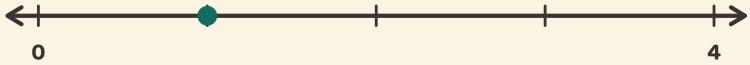

$\frac{2}{4}$ $\frac{1}{6}$ $\frac{1}{4}$

3

0 → 1 in 3 steps

$\frac{2}{5}$ $\frac{1}{3}$ $\frac{2}{3}$

4

0 → 1 in 6 steps

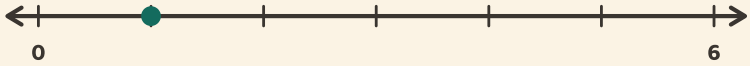

$\frac{2}{6}$ $\frac{1}{6}$ $\frac{2}{8}$